EXERCISE:

86. Assign Lewis structures to the following molecules.

(a)

(b)

(c)

(d) 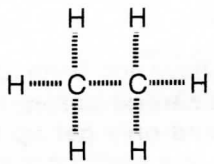

(e)

(f)

(g)

(h)

(i) 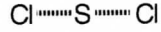

(j)

(k)

(l) 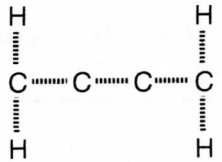

(m)

(n) 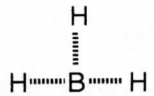

(o)

(p)

(q)

(r)

(s)

(t)

(u)

(v) 

(w)

(x)

(y) 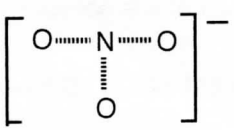

(z) 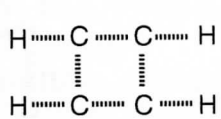

(aa) 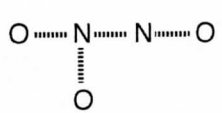

(bb) 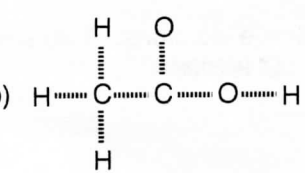

(cc) 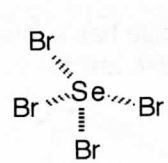

86. (a) 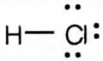
(b) 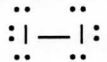
(c) 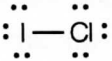

(d) 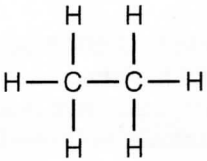
(e) 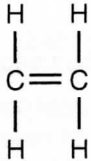
(f)

(g) 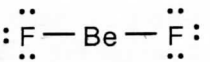
(h)
(i) 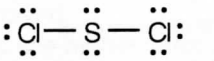

(j)
(k)
(l) 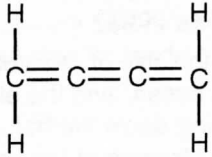

(m)
(n) 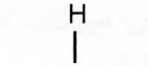
(o) 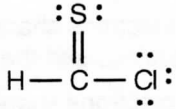

(p) 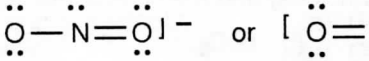
(q) 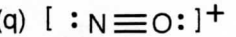

(r) 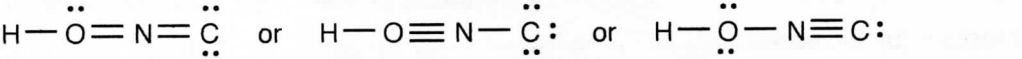

(s) 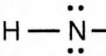
(t) 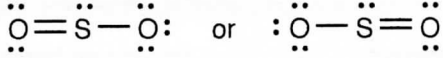

(u) 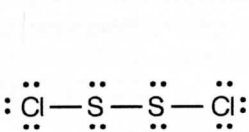
(v) 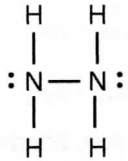
(w) 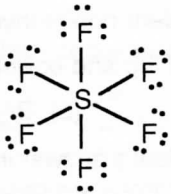

(x) 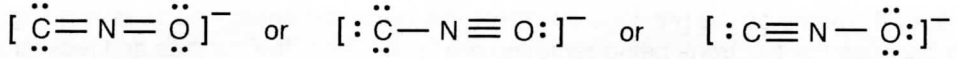

(y) 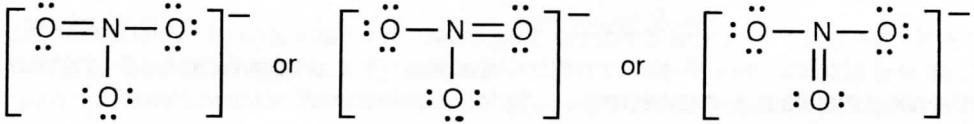

(z) 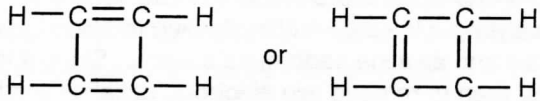

(aa) 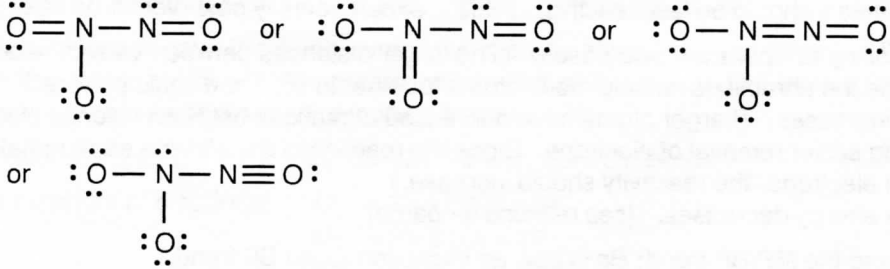

(bb) 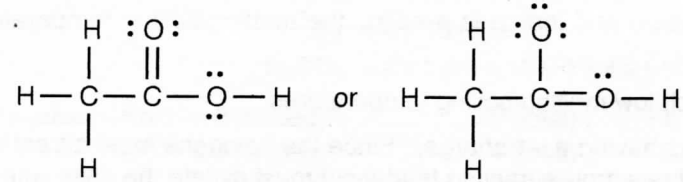
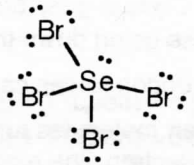
(cc)